Name: **Math 1**

Date: **Practice Quiz 8-C**

1. Given the two polygons are congruent, identify a side or angle congruent to the one stated.

a) *EW* b) *AR* c) ∠*CAR*

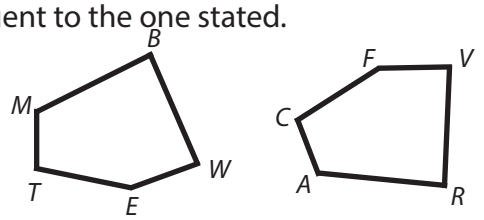

2. Prove that the triangles at right are congruent.

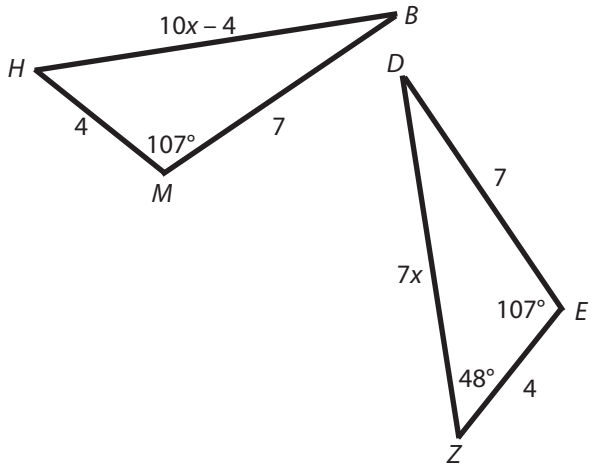

3. Find the following values in the triangles above.

a) *x* b) *DZ*

Name: **Math 1**

Date: **Practice Quiz 8-C**

1. Given the two polygons are congruent, identify a side or angle congruent to the one stated.

a) *EW* b) *AR* c) ∠*CAR*

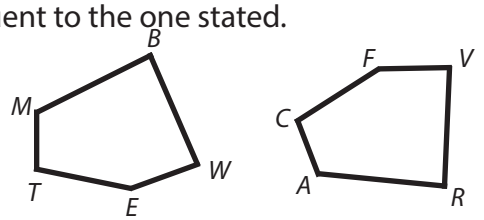

2. Prove that the triangles at right are congruent.

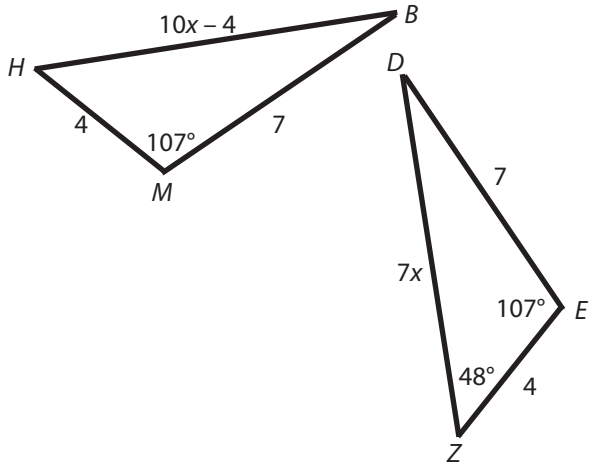

3. Find the following values in the triangles above.

a) *x* b) *DZ*